→ Textbook 4C p40

Pounds and pence

1 How much money is in each box?

Write each amount in pence. Add the 100s first.

a)

☐ pence

b)

☐ pence

c)

☐ pence

2 How much money is in each box?

Write each amount in pounds and pence.

a)

☐ pounds

☐ pence

b) 

☐ pounds

☐ pence

c) 

☐ pounds

☐ pence

3 **a)** Circle £8·72.

b) Circle £12·18.

4 Complete the part-whole models.

a)

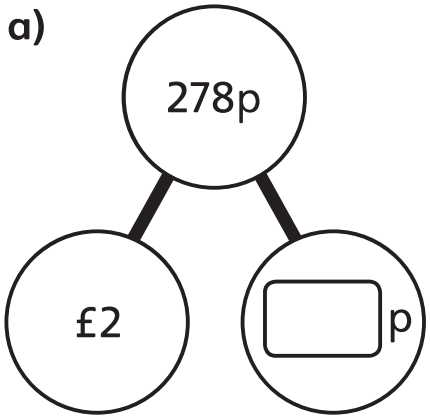

b)

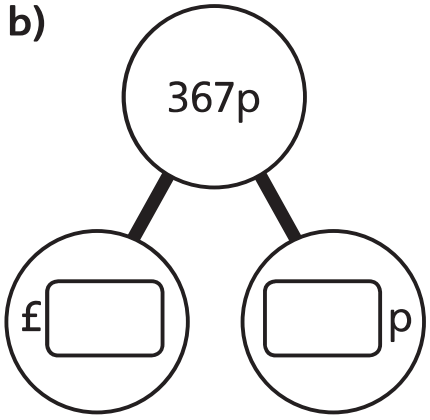

c)

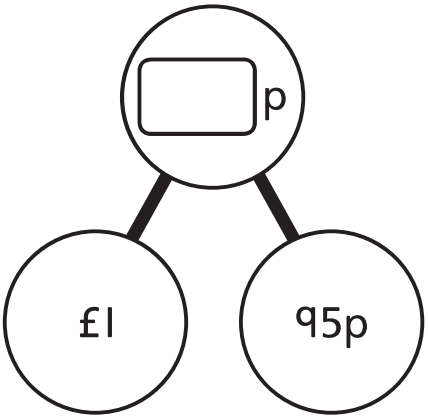

d)

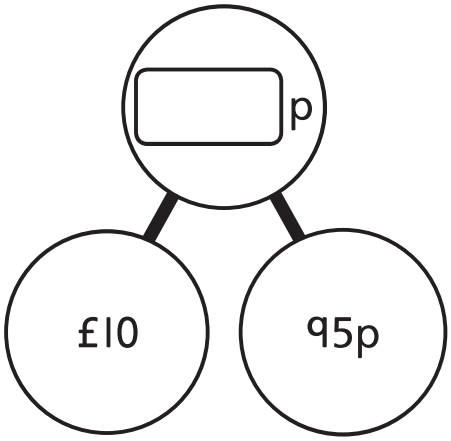

5 Write the totals in pounds and pence.

a) £1 + 50p + 20p + 20p + 5p + 2p = £ ☐·☐

b) £1 + £1 + £1 + 50p + 50p + 5p + 1p = £ ☐·☐

c) 20p + £1 + 50p + 10p + 50p + 10p = £ ☐·☐

6 Complete the following equivalents.

a) 258p = £ ☐

b) 370p = £ ☐

c) 408p = £ ☐

d) 1,257p = £ ☐

e) £1·18 = ☐ p

f) £8·95 = ☐ p

g) ☐ p = £2·09

h) ☐ p = £2·90

i) £11·15 = ☐ p

j) £9 = ☐ p

7 Four boxes contain different amounts of money.

CHALLENGE

- Box A contains 300p.
- Box B contains 10 times as much as Box A.
- Box C contains 10p more than Box A.
- Box D contains 100p less than Box B.

How much money is in each box?

Write your answers in pounds.

Box A = £ ☐ Box B = £ ☐ Box C = £ ☐ Box D = £ ☐

Reflect

Describe three ways you can write how much money is here in total.